Make equal groups – grouping

1 Annie has 10 apples.



Annie has some plates.

She wants to put 2 apples on each plate.

Show how Annie groups the apples.

Complete the sentences.

There are ☐ apples.

There are ☐ apples on each plate.

There are ☐ plates.

2 Take 15 counters.

Put the counters into groups of 3

Complete the sentences.

There are 15 counters.

The counters are in groups of ☐

There are ☐ groups.

3 Mo has 20 chairs.

a) Circle groups of 5 chairs.

b) How many groups did you circle? ☐

c) Complete the number sentence.

☐ ÷ ☐ = ☐

© White Rose Maths 2019

4 Complete the number sentences.

Use the number line to help you.

a) 30 ÷ 10 = ☐

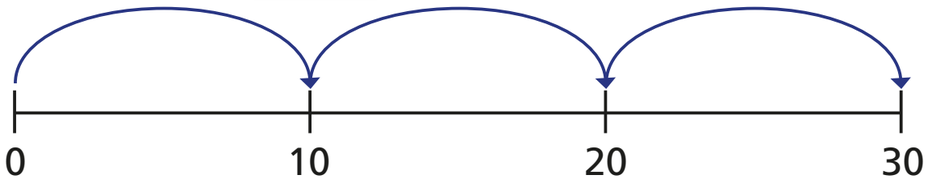

30 is made of ☐ equal groups of ☐

b) 30 ÷ 5 = ☐

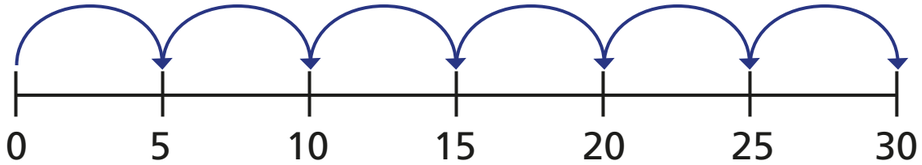

30 is made of ☐ equal groups of ☐

c) Investigate other equal groups you could make with 30

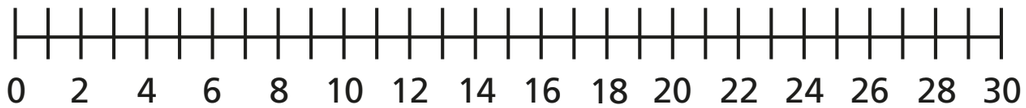

Talk about it with a partner.

5 Eva is putting 24 pencils into pots.



She puts 2 pencils into each pot.

How many pots does Eva need?

☐ ÷ ☐ = ☐

Eva needs ☐ pots.

6

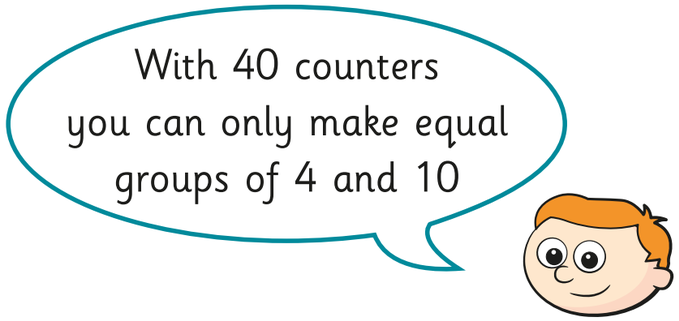

Is Ron correct? _____

Use counters to show how you know.

© White Rose Maths 2019